認識假分數

 表示 1 個蛋糕。以分數表示下列各圖有**多少個蛋糕**。 (先把名數圈出)

1. 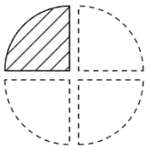

1 份即是_____個蛋糕

2. 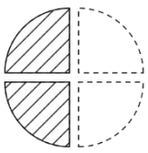

_____份即是_____個蛋糕

3. 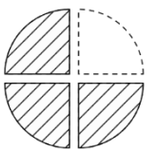

_____份即是_____個蛋糕

4. 

_____份即是_____個蛋糕

5. 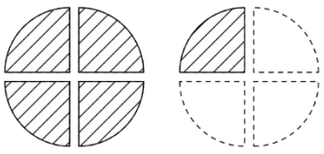

_____份即是_____個蛋糕

6. 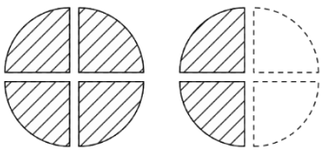

_____份即是_____個蛋糕

7. 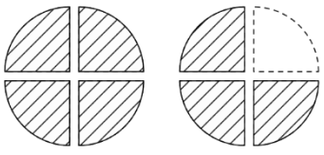

_____份即是_____個蛋糕

8. 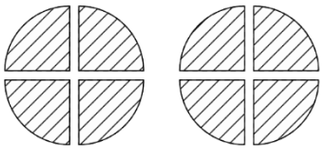

_____份即是_____個蛋糕

分子**小於**分母的分數稱為**真分數**，分子**等於**分母或**大於**分母的分數稱為**假分數**。

以上哪些分數是真分數？_____

以上哪些分數是假分數？_____

以上哪些分數的數值是整數？_____

 表示 1 個蛋糕。在下列各圖中以  表示蛋糕的數量。

9. $\frac{5}{3}$ 個蛋糕 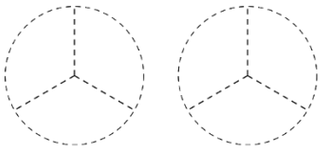

10. $\frac{9}{6}$ 個蛋糕 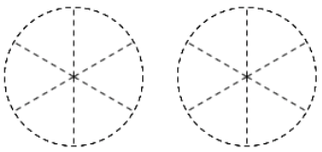

11. $\frac{14}{4}$ 個蛋糕 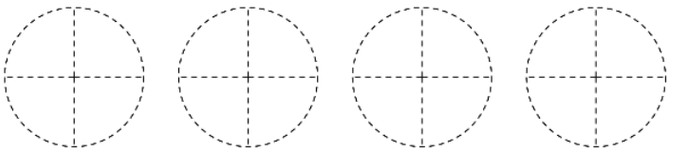

12. $\frac{4}{2}$ 個蛋糕 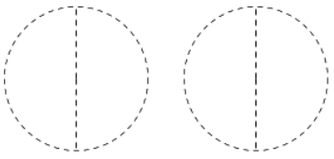

13. $\frac{18}{8}$ 個蛋糕 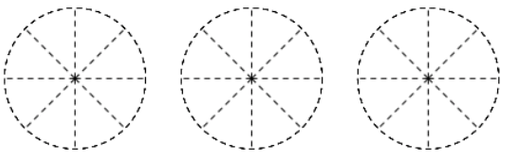

14. $\frac{40}{10}$ 個蛋糕 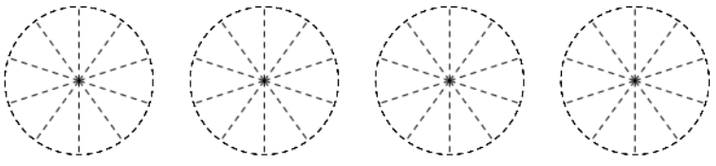

以上哪些分數是真分數？_____

以上哪些分數是假分數？_____

以上哪些分數的數值是整數？_____